Prénom : _____

Evaluation diagnostique

Entoure uniquement les chiffres :

9 A F S 1 6 U 4 K 8 5 7 3 G Y H 2

Récite la comptine numérique :

1 2 3 4 5 6 7 8 9 10 11 12 13 14 15 16 17 18 19 20

21 22 23 24 25 26 27 28 29 30 31 32 33 34 35 36 37 38 39 40

Reproduis les graphies (lignes brisées et boucles) :

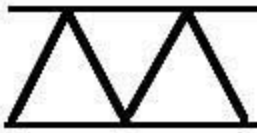



Colorie le plus grand poisson en rouge

le plus petit en bleu







www.fiche-maternelle.com